Oregon Extended Assessment

Elementary Practice Test

The Elementary Practice Test provides sample content and item types for ELA, Math, and Science, grades 3-5.

English Language Arts



Mathematics

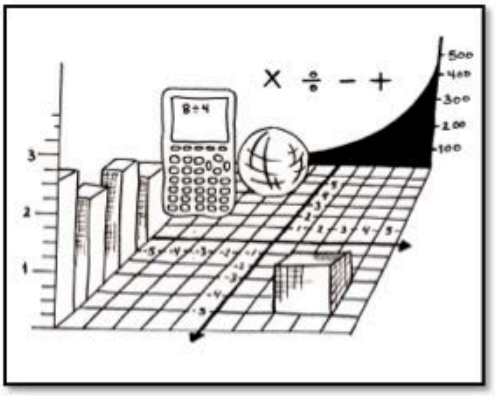

Science

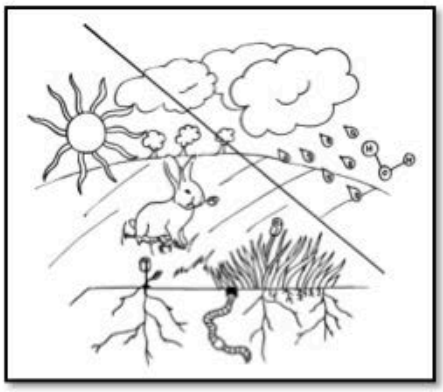

OREGON DEPARTMENT OF EDUCATION
Oregon achieves . . . together!

Equity, Accountability, Excellence & Integrity

BRT
behavioral research & teaching

Item 1	**A**	**B**	**C**	**Correct**	**Response**
Here are three words. (Point to answer choices.) Which word is ship? (Do not read answer choices.)	ship	sepp	shop	A	

Item 2	**A**	**B**	**C**	**Correct**	**Response**
Here are three words. (Point to student materials.) I will read sentences to you. Follow along. My mom likes to visit the library. She goes to read books. She likes to read books about plants. Where does my mom like to visit? house, library, books?	house	library	books	B	

Item 3	**A**	**B**	**C**	**Correct**	**Response**
Here are three words and sentences for you to read. (Point to student materials and pause for students to read the sentences.) Where do we go after the bell rings? (Do not read answer choices.)	lunch	recess	math	B	

Item 4	**A**	**B**	**C**	**Correct**	**Response**
Here are two trees with some apples. (Point to student materials.) There are 8 apples all together. How many apples are on one tree: 4, 5, 6?	4	5	6	A	

Item 5	**A**	**B**	**C**	**Correct**	**Response**
Here are three circles with lines. (Point to student materials.) Which circle appears to have a line that divides it in half? (Do not read answer choices.) A, B, C?	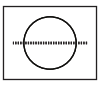	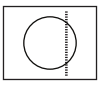	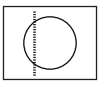	A	

Item 6	**A**	**B**	**C**	**Correct**	**Response**
Here is a word problem about Sarah and her fish.(Point to student materials.) Sarah has 2 fish and gets 3 more. How many fish does she have all together: 3, 4, 5?	3	4	5	C	

Item 7	**A**	**B**	**C**	**Correct**	**Response**
Here are three expressions. (Point to student materials.) Which expression shows thirty-five minus fifteen? (Do not read answer choices.) A, B, C?	35 - 15	35 + 15	30 - 5	A	

Item 8	**Response**
Here is a word for you to trace. (Point to words.) Trace the word ruler.	

Item 9	**A**	**B**	**C**	**Correct**	**Response**
Here is a whale. (Point to student materials.) Where do whales live: mountain, desert, ocean?	mountain	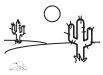 desert	ocean	C	

Item 10	**Response**
You will copy two words here. (Point to words.) Write the words "come back." (Student receives a point if they write the two words legibly and you know what they are, even though there may be misspellings in the words.)	

Item 11	**A**	**B**	**C**	**Correct**	**Response**
Here is a bird. (Point to student materials.) If a bird drops a worm, which direction will gravity force it: up, sideways, down?	up	 sideways	down	C	

Item 12	**Response**
You will write a sentence here. (Point to lines for writing.) Write the words "Go to sleep now."	

Item 1

ship	sepp	shop

Item 2

My mom likes to visit the library. She goes to read books. She likes to read books about plants.

Where does my mom like to visit?

house	library	books

Item 3

First, the bell rings. Then we line up and go to recess.

Where do we go after the bell rings?

lunch	recess	math

Item 4

How many apples are on one tree?



$8 \div 2 = ____$

4	5	6

Item 5

Which circle appears to have a line that divides it in half?

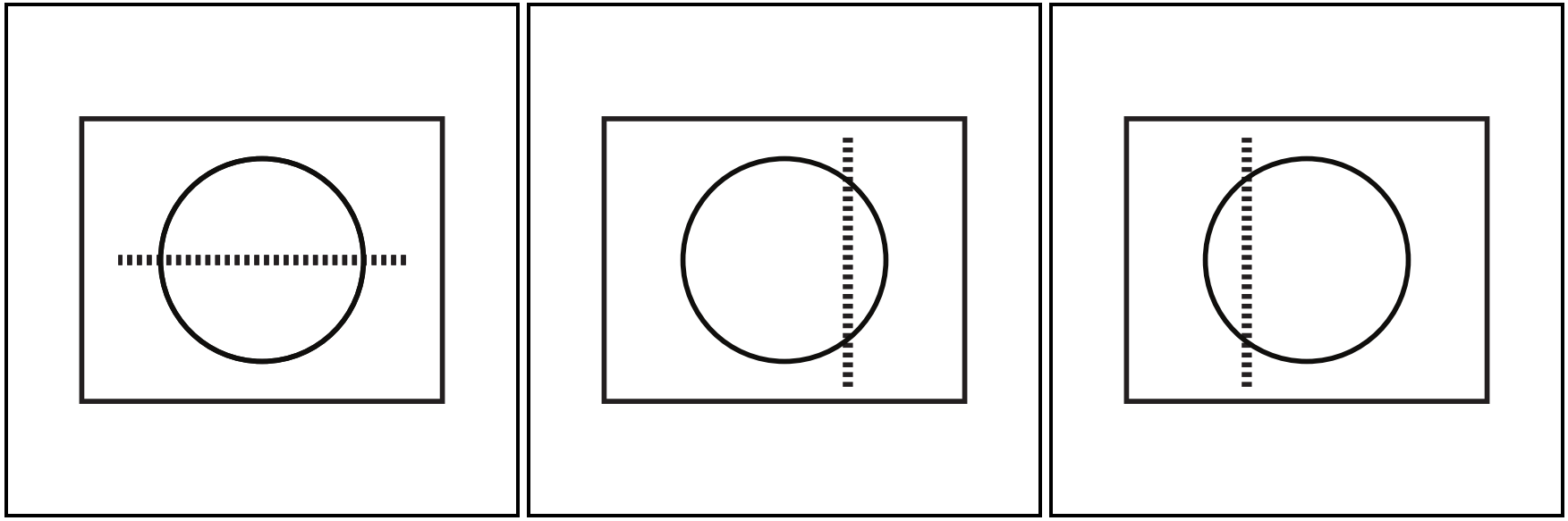

Item 6

Sarah has 2 fish and gets 3 more.

2 + 3 = ___?

How many fish does she have all together?

3	4	5

Item 7

Which expression shows thirty-five minus fifteen?

35 - 15	35 + 15	30 - 5

Item 8



Item 9

Where do whales live?

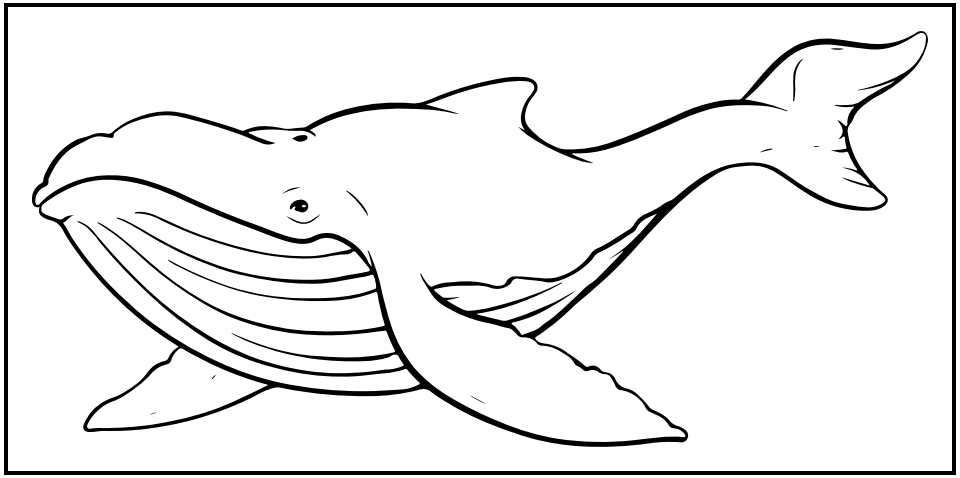



mountain



desert



ocean

Item 10

come back

Item 11

If a bird drops a worm, which direction will gravity force it?





up

sideways



down
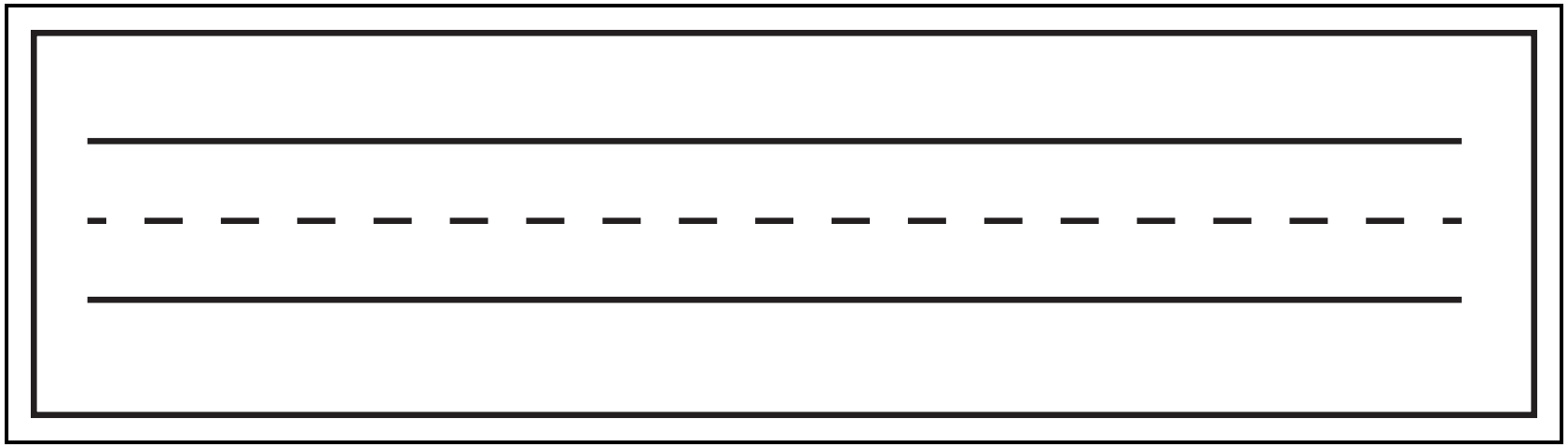
Item 12